Finding Distance on a Grid

Name:

Find the distance between points.

Ex)

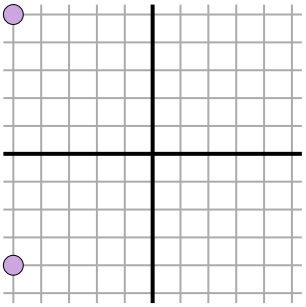

1)

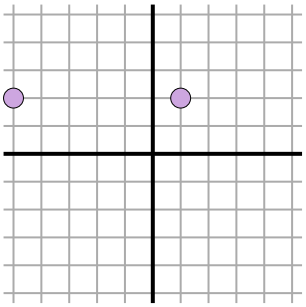

2)

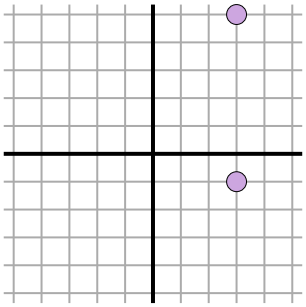

3)

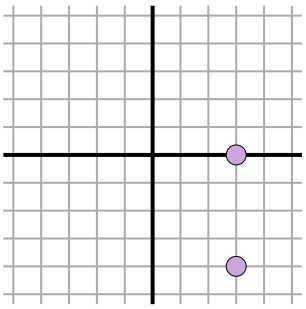

4)

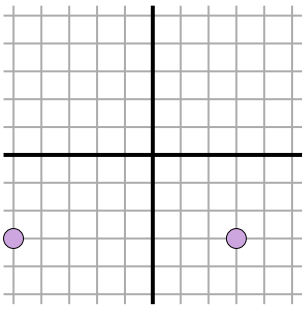

5)

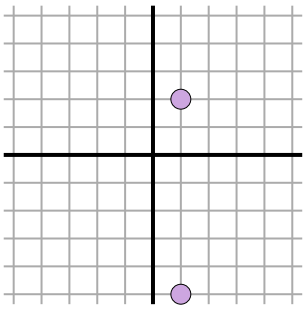

6)

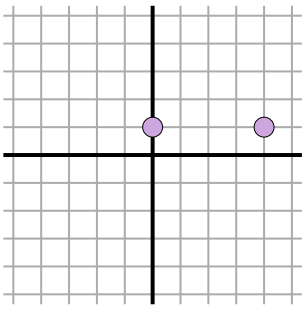

7)

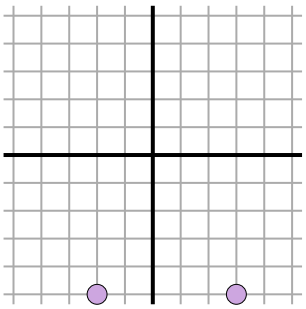

8)

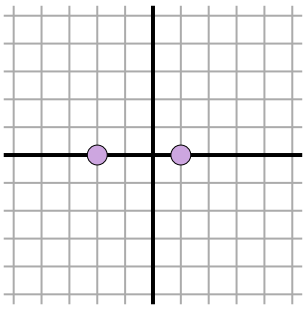

9)

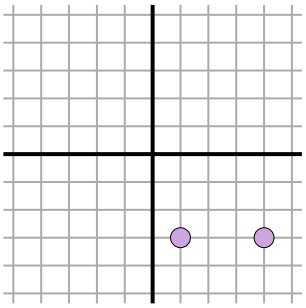

10)

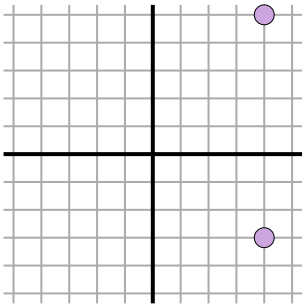

11)

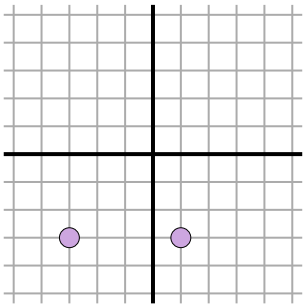

Answers

Ex. 9

1. _____

2. _____

3. _____

4. _____

5. _____

6. _____

7. _____

8. _____

9. _____

10. _____

11. _____

1-10	91	82	73	64	55	45	36	27	18	9
11	0									

Finding Distance on a Grid

Name: **Answer Key**

Find the distance between points.

Ex)

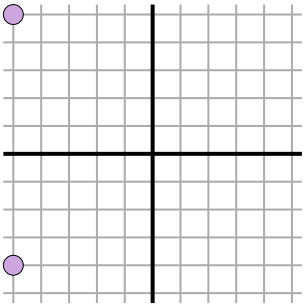

$\sqrt{(-5--5)^2 + (-4-5)^2}$

$\sqrt{(0) + (81)}$

1)

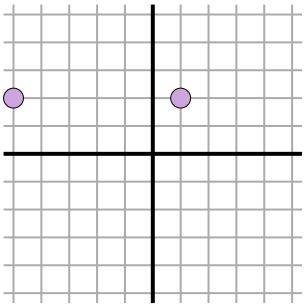

$\sqrt{(-5-1)^2 + (2-2)^2}$

$\sqrt{(36) + (0)}$

2)

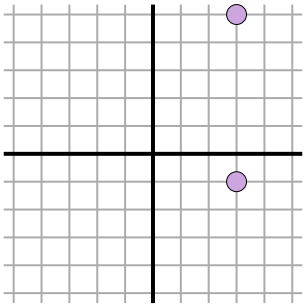

$\sqrt{(3-3)^2 + (-1-5)^2}$

$\sqrt{(0) + (36)}$

3)

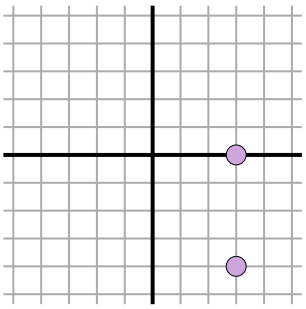

$\sqrt{(3-3)^2 + (0--4)^2}$

$\sqrt{(0) + (16)}$

4)

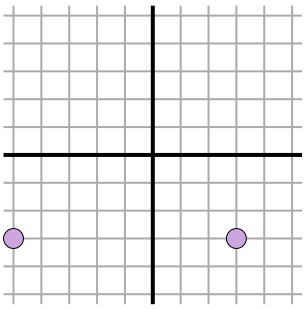

$\sqrt{(-5-3)^2 + (-3--3)^2}$

$\sqrt{(64) + (0)}$

5)

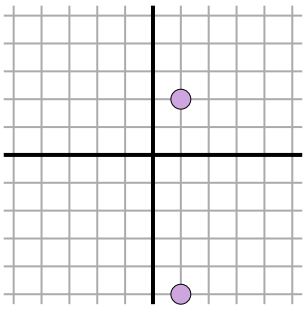

$\sqrt{(1-1)^2 + (-5-2)^2}$

$\sqrt{(0) + (49)}$

6)

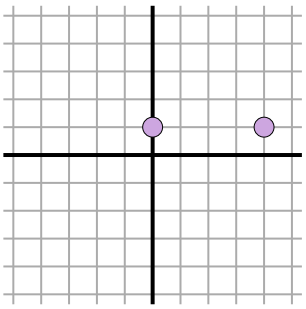

$\sqrt{(0-4)^2 + (1-1)^2}$

$\sqrt{(16) + (0)}$

7)

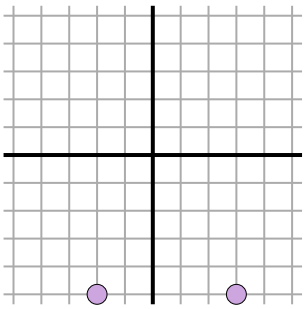

$\sqrt{(3--2)^2 + (-5--5)^2}$

$\sqrt{(25) + (0)}$

8)

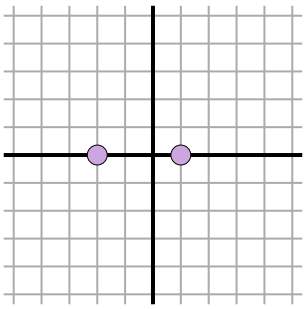

$\sqrt{(1--2)^2 + (0-0)^2}$

$\sqrt{(9) + (0)}$

9)

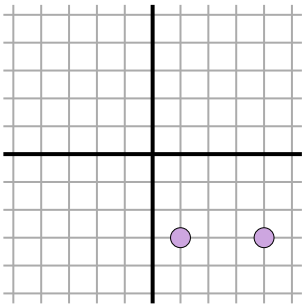

$\sqrt{(1-4)^2 + (-3--3)^2}$

$\sqrt{(9) + (0)}$

10)

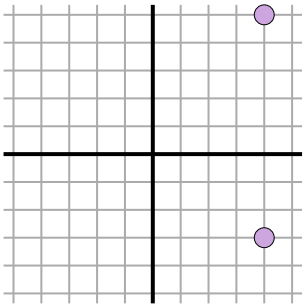

$\sqrt{(4-4)^2 + (-3-5)^2}$

$\sqrt{(0) + (64)}$

11)

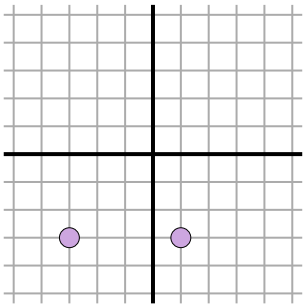

$\sqrt{(1--3)^2 + (-3--3)^2}$

$\sqrt{(16) + (0)}$

Answers

Ex.	9
1.	6
2.	6
3.	4
4.	8
5.	7
6.	4
7.	5
8.	3
9.	3
10.	8
11.	4

1-10	91	82	73	64	55	45	36	27	18	9
11	0									